Name _____ Datum _____ Klasse ____

©http://aufgaben.schulkreis.de

Zahlenmauern, Blatt 7

Rechnen bis 100 mit 4 Grundsteinen

Aufgabe 1

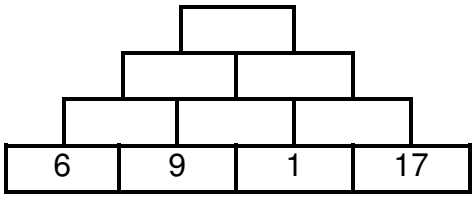

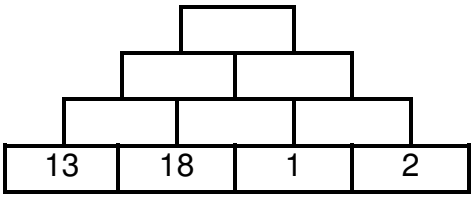

Aufgabe 2

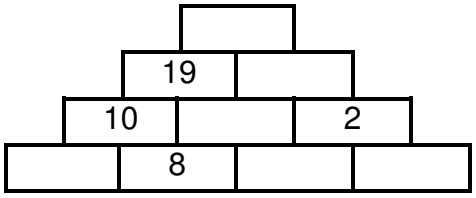

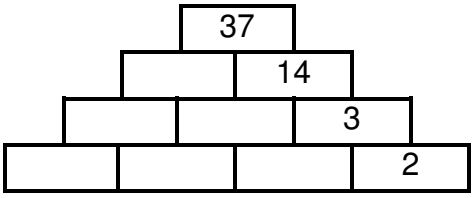

Aufgabe 3

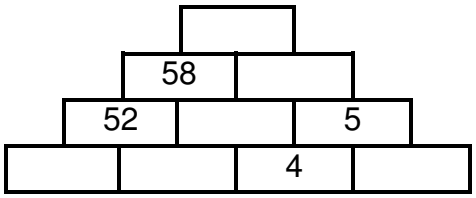

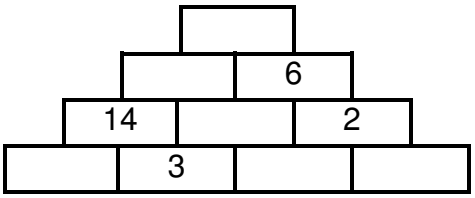

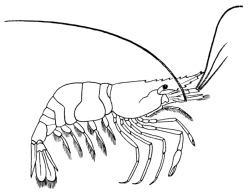

Lösung: Zahlenmauern, Blatt 7

Rechnen bis 100 mit 4 Grundsteinen

Aufgabe 1

53			
25	28		
15	10	18	
6	9	1	17

72			
50	22		
31	19	3	
13	18	1	2

Aufgabe 2

30			
19	11		
10	9	2	
2	8	1	1

37			
23	14		
12	11	3	
2	10	1	2

Aufgabe 3

69			
58	11		
52	6	5	
50	2	4	1

24			
18	6		
14	4	2	
11	3	1	1