Name _____ *Datum* _____ *Klasse* ____

©*http://aufgaben.schulkreis.de*

Zahlenmauern, Blatt 9

Rechnen bis 20 mit 3 Grundsteinen

Aufgabe 1

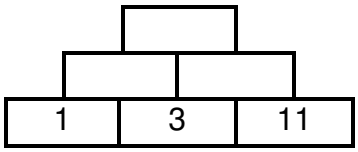

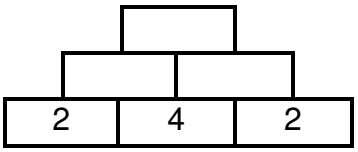

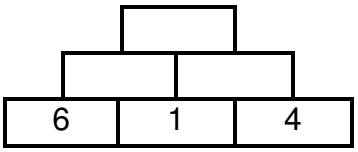

Aufgabe 2

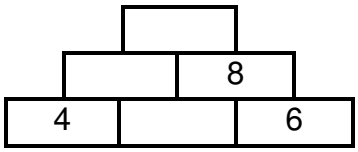

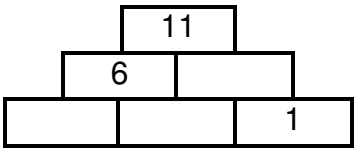

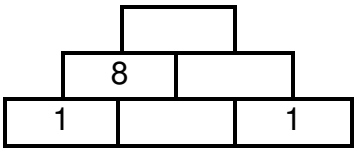

Aufgabe 3

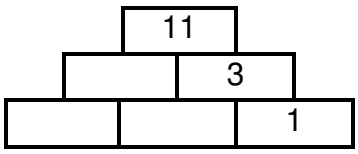

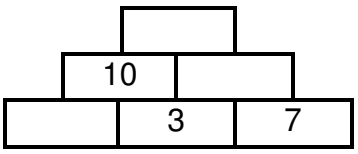

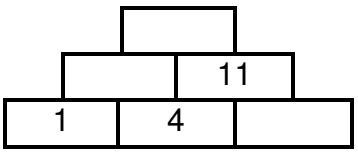

Aufgabe 4

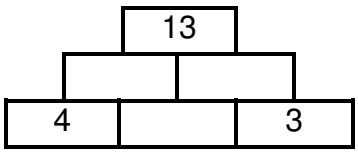

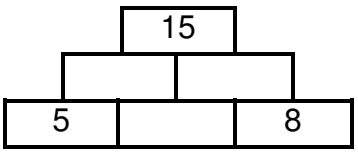

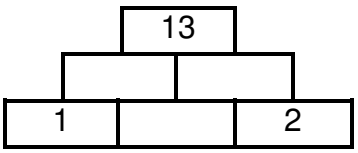

Lösung: Zahlenmauern, Blatt 9

Rechnen bis 20 mit 3 Grundsteinen

Aufgabe 1

	18	
4		14
1	3	11

	12	
6		6
2	4	2

	12	
7		5
6	1	4

Aufgabe 2

	14	
6		8
4	2	6

	11	
6		5
2	4	1

	16	
8		8
1	7	1

Aufgabe 3

	11	
8		3
6	2	1

	20	
10		10
7	3	7

	16	
5		11
1	4	7

Aufgabe 4

	13	
7		6
4	3	3

	15	
6		9
5	1	8

	13	
6		7
1	5	2